Math 7/7+ Name_____

© 2018 Kuta Software LLC. All rights reserved.

Volume of Prisms

Date_____ Period____

Find the volume of each figure. Round your answers to the nearest tenth, if necessary.

1)

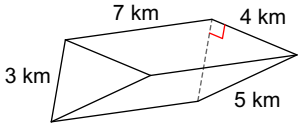

2)

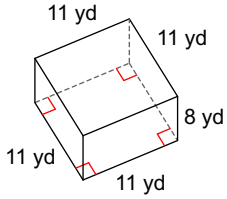

3)

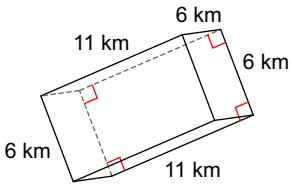

4)

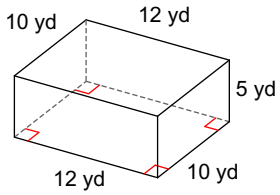

5)

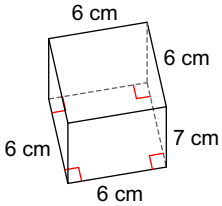

6)

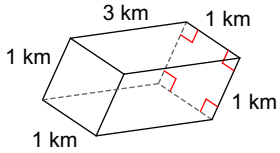

7)

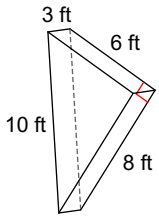

8)

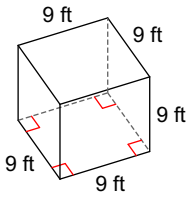

9)

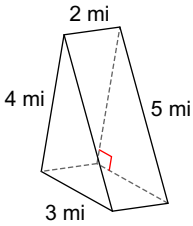

10)

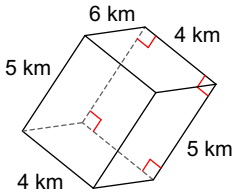

© 2018 Kuta Software LLC. All rights reserved. Made with Infinite Geometry.